50. Calculate TC/PW and determine long, medium, or short.

	R	L	Freq	TC	PW	TC/PW	L/M/S
a.	20KΩ	100mh	100Hz				
b.	20KΩ	20mh	5KHz				
c.	1KΩ	10mh	25KHz	_____	_____	_____	

51. Calculate TC/PW and Determine long, medium, or short & type of circuit.

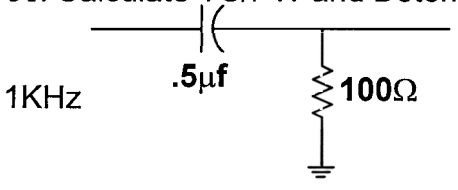

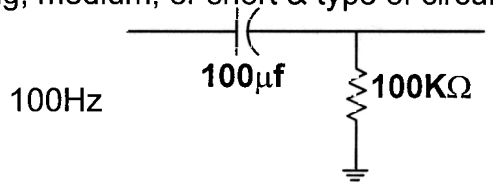

A: TC/PW_____

L/M/S_____

Type_____

B: TC/PW_____

L/M/S_____

Type_____

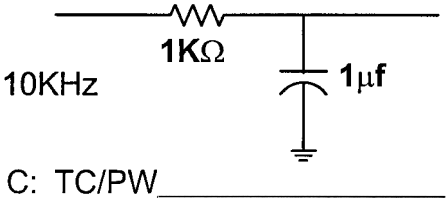

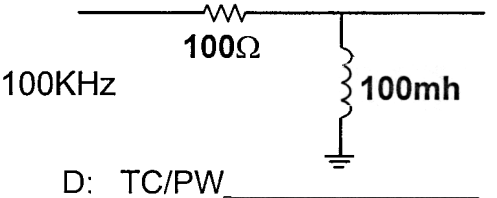

C: TC/PW_____

L/M/S_____

Type_____

D: TC/PW_____

L/M/S_____

Type_____

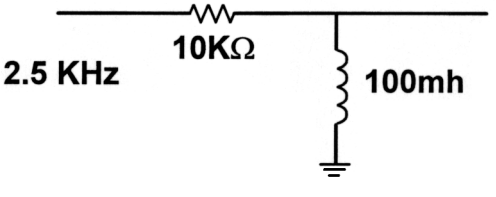

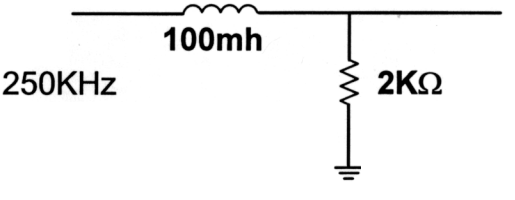

E: TC/PW_____

L/M/S_____

Type_____

F: TC/PW_____

L/M/S_____

Type_____